Math 2A Name_____ ID: 1

3.1 Functions

Date_____ Period____

Determine if the following represent functions. Write yes or no next to each one.

1)

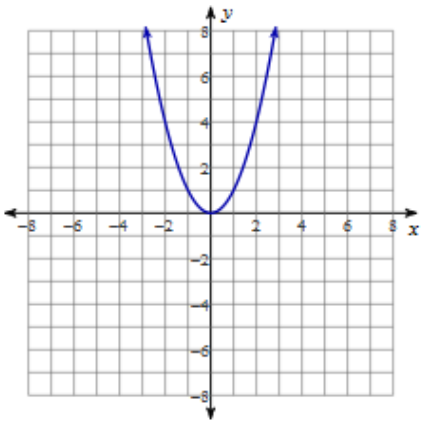

2)

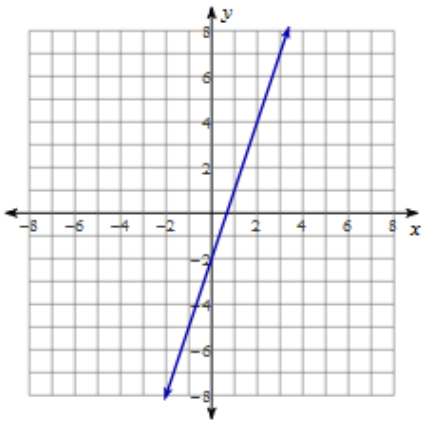

3)

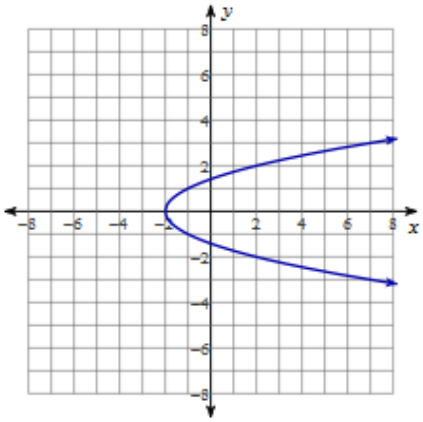

4)

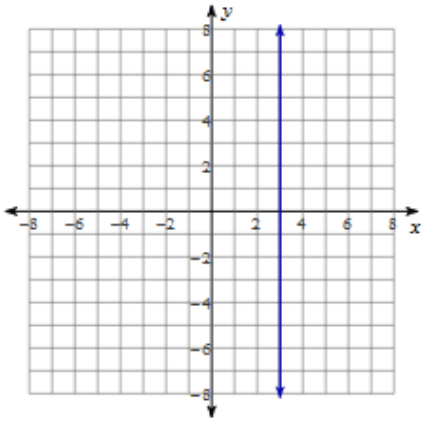

5)

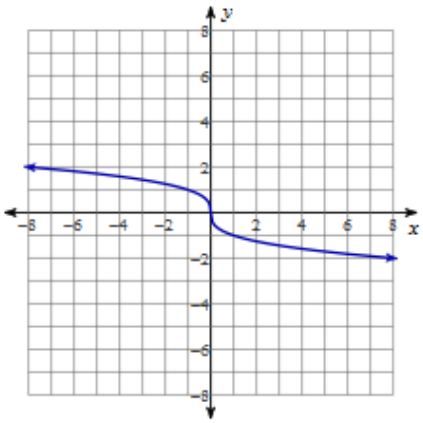

6)

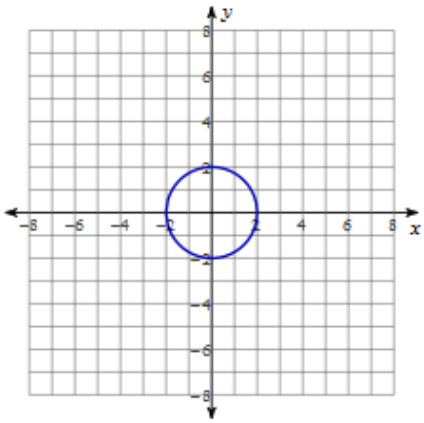

7)

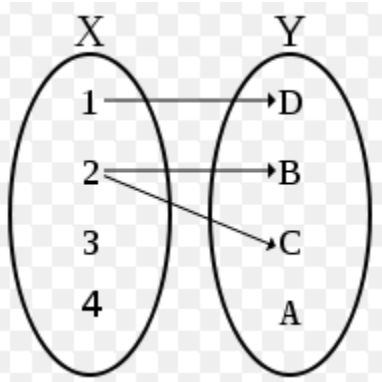

8)

x	3	5	7	3
y	1	2	3	4

9)

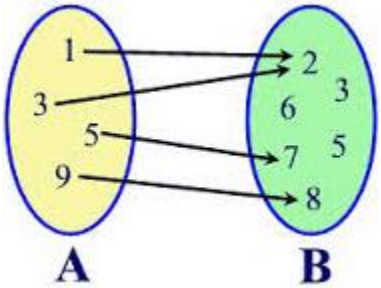

10)

(1, 6), (1, 3), (3, -4), (-8, 7)

11)

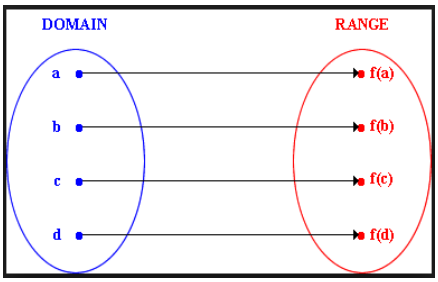

12)

$\{(1, 6), (2, 3), (4, 3), (5, 7)\}$

13)

x	-3	-2	-1	0	1	2	3
y	1	-2	2	4	-3	-2	-1

14)

$\{(1, 6), (2, 3), (1, 3), (5, 7)\}$